Name the interval I

The name of the note is not important. Look at the pattern.

Is it a step (2nd) or a skip (3rd)?

- A step is the note next door.
- A skip misses a note.



Step - 2nd